# NCERT SOLUTIONS

## CLASS - 2nd



aglasem.com

Class : 2nd
Subject : Maths
Chapter : 8
Chapter Name : Tens And Ones

---

Q1 Can you do this without Uncle's help? Draw the 10-rupee notes and 1-rupee coins you will give for these things.

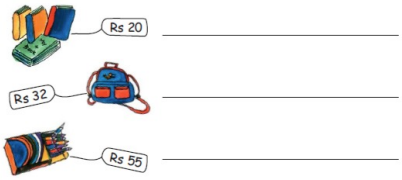


Answer.



Page : 57 , Block Name : Tens And Ones

Q2 How much money do the notes and coins make?

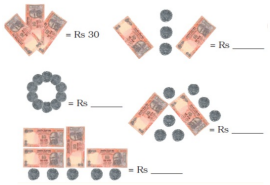


Answer.

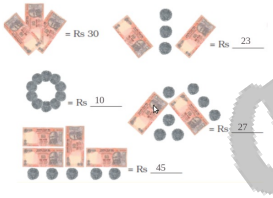


Page : 57 , Block Name : Tens And Ones

Q1 Now you write these and also say them aloud.
27 = ____ + 7
31 = 30 + ____
54 = ____ + ____
____ = 90 + 9
63 = ____ + ____
36 = ____ + ____
____ = 80 + 2

Answer.
27 = 20 + 7
31 = 30 + 1
54 = 50 + 4
99 = 90 + 9

aglasem.com

63 = 60 + 3
36 = 30 + 6
82 = 80 + 2

Page : 58 , Block Name : Practice Time

Q2 You try writing the break-up for these.
12 = 10 + 2
19 = ____ + 9
11 = ____ + ____
____ = 10 + 7

Answer.
19 = 10 + 9
11 = 10 + 1
17 = 10 + 7

Page : 58 , Block Name : Practice Time

Q1 Which cards will he have in his pocket if he has counted up to

(a) 23 ⟶ 

b) 47
c) 55
d) 63
e) 72
f) 80

Answer.

(a) 23 ⟶ 
(b) 47 ⟶ 
(c) 55 ⟶ 
(d) 63 ⟶ 
(e) 72 ⟶ 
(f) 80 ⟶ 

aglasem.com

Page : 62 , Block Name : The Flute Man And The Rats

Q1 How many teams will there be in each class? How many students will be left? Write here.

| | *How many teams?* | *Students left* |
|---|---|---|
| *Class 1* | | |
| *Class 2* | | |
| *Class 3* | | |
| *Class 4* | | |
| *Class 5* | | |

Answer.

| | How many teams? | Students left |
|---|---|---|
| Class 1 | 5 | 3 |
| Class 2 | 4 | 2 |
| Class 3 | 3 | 5 |
| Class 4 | 5 | 4 |
| Class 5 | 2 | 6 |

Page : 65 , Block Name : Clean School Day

Q2 How many students are left in all?

Answer. 20 students are left in all.

Page : 65 , Block Name : Clean School Day

Q3 How many more teams can be made with all these students left?

Answer. 2 more teams can be made with all these students left.

Page : 65 , Block Name : Clean School Day

Q1 Find out the number of children in each class of your school.

Answer. DIY

Page : 65 , Block Name : Practice Time : Teams Of Ten In Your School

Q2 Make teams of ten for each class.

Answer. DIY

Page : 65 , Block Name : Practice Time : Teams Of Ten In Your School

Q3 How many children are left in each class?

Answer. DIY

Page : 65 , Block Name : Practice Time : Teams Of Ten In Your School

aglasem.com