Career Aglasem

Constable (GD) in CAPFs, NIA, SSF and Rifleman (GD) in Assam Rifles Examination, 2018

Roll No. :	[redacted]
Registration No.	
Name :	
Exam Venue :	
Exam Time :	9:00 AM - 10:30 AM
Exam Date :	07/03/2019

Section : **General Section**

Q.1 Find the missing number from the below options.

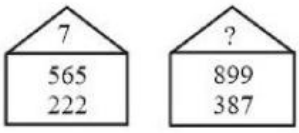

Ans
✔ 1. 8
✗ 2. 9
✗ 3. 11
✗ 4. 6

Question ID : **9895809215**
Chosen Option : **3**

Q.2 Select the option that is related to the third term in the same way as the second term is related to the first term.

0.24 : 0.0024 :: 3.03 : ?

Ans
✗ 1. 3.030
✗ 2. 0.303
✗ 3. 30.30
✔ 4. 0.0303

Question ID : **9895809213**
Chosen Option : **4**

Q.3 Five people Palak, Karol, Risha, Saloni and Tisha are travelling in a car. The car has two seats in the front and three at the back. Risha is driving the car. Palak wants to sit at one of the window seats at the back of the car. Tisha wants to sit next to Palak. Karol hates Tisha and will not sit with Tisha. Who is sitting next to the driver?

Ans
✔ 1. Karol
✗ 2. Tisha
✗ 3. Can't be determined
✗ 4. Saloni

Question ID : **9895809206**
Chosen Option : **2**

Q.4

aglasem.com

Select the correct option that will fill in the blank and complete the series.

45, 49, 58, 74, ___

Ans
1. 92 ✗
2. 88 ✗
3. 99 ✓
4. 98 ✗

Question ID : **9895809211**
Chosen Option : **2**

Q.5 Four words have been given out of which three are alike in some manner, while one is different. Choose the odd one.

Ans
1. Bottle ✗
2. Bucket ✗
3. River ✓
4. Jar ✗

Question ID : **9895809200**
Chosen Option : **3**

Q.6 Select the correct option that will fill in the blank and complete the series.

35, 40, 55, 80, 115, ?

Ans
1. 155 ✗
2. 170 ✗
3. 165 ✗
4. 160 ✓

Question ID : **9895809212**
Chosen Option : **4**

Q.7 The statements below are followed by two conclusions labeled I and II. Assuming that the information in the statements is true, even if it appears to be at variance with generally established facts, decide which conclusion(s) logically and definitely follow(s) from the information given in the statements.

Statements:

Some cows are deer.

Some deer are fishes.

Conclusion:

I. Some cows are fishes.

II. Some fishes are cows.

Ans
1. Either conclusion I or II follows ✗
2. Neither conclusion I nor II follows ✓
3. Only conclusion I follows ✗
4. Only conclusion II follows ✗

Question ID : **9895809209**
Chosen Option : **1**

Q.8

Career Aglasem

Choose the option that most closely resembles the mirror image of the given figure when mirror is placed at right side.

Questions Figure:



Ans

✗ 1. 

✗ 2. 

✔ 3. 

✗ 4. 

Question ID : **9895809220**
Chosen Option : **3**

Q.9 Choose the option figure in which the problem figure is hidden/embedded.

Question Figures:



Ans

✗ 1. 

✔ 2. 

✗ 3. 

✗ 4. 

Question ID : **9895809219**
Chosen Option : **1**

Q.10

Career Aglasem

The statements below are followed by three conclusions labeled I, II and III. Assuming that the information in the statements is true, even if it appears to be at variance with generally established facts, decide which conclusion(s) logically and definitely follow(s) from the information given in the statements.

Statements:

All pencils are houses.
All houses are eraser.

Conclusions:

I. Some pencils are eraser.

II. Some erasers are pencils.

III. All erasers are pencils.

Ans
1. ✗ Only I and II follow
2. ✗ None follows
3. ✓ Only II follows
4. ✗ All follow

Question ID : **9895809210**
Chosen Option : **4**

Q.11 Select the related word pair from the given alternatives.

Poet : Poem :: _____ : _____

Ans
1. ✗ Paragraph : Lyrics
2. ✗ Maths : literature
3. ✓ Author : Book
4. ✗ Instrument : Video

Question ID : **9895809201**
Chosen Option : **3**

Q.12 Select the option that is related to the fourth term in the same way as the first term is related to the second term.

BDGK : CEHL :: ???? : DFIM

Ans
1. ✓ CEHL
2. ✗ CEHM
3. ✗ EGJN
4. ✗ EGHI

Question ID : **9895809202**
Chosen Option : **1**

Q.13 Select the option that is related to the third term in the same way as the second term is related to the first term.

ACEG : BDFH :: CEGI : ?

Ans
1. ✗ EGIK
2. ✓ DFHJ
3. ✗ DHIK
4. ✗ EGIH

Question ID : **9895809203**

Career Aglasem

Chosen Option : **4**

Q.14 A is 15th from the front in a column of boys. There were thrice as many behind him as there were in front. How many boys are there between A and the 7th boy from the end of the column?

Ans
✔ 1. 35
✘ 2. 40
✘ 3. 33
✘ 4. 34

Question ID : **9895809208**
Chosen Option : **3**

Q.15 If B is coded as 9, F is coded as 3, Q is coded as 2, D is coded as 8, T is coded as 1, M is coded as 6, and K is coded as 7, then what is the coded form of FBMKQT?

Ans
✘ 1. 396127
✔ 2. 396721
✘ 3. 369127
✘ 4. 369172

Question ID : **9895809205**
Chosen Option : **2**

Q.16 Choose the option which come next in the given figure series.

Problem Figures

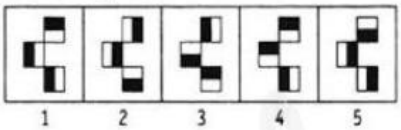

Ans
✘ 1. 
✘ 2. 
✘ 3. 
✔ 4. 

Question ID : **9895809217**
Chosen Option : **2**

Q.17 Four options have been given out of which three are alike in some manner, while one is different. Choose the odd one.

Ans
✘ 1. 426
✘ 2. 336
✘ 3. 257
✔ 4. 359

Career Aglasem

Question ID : **9895809214**
Chosen Option : **1**

Q.18 Which of the following answer figure will complete the given figure?

Question Figures:



Ans

✗ 1. 

✗ 2. 

✗ 3. 

✓ 4. 

Question ID : **9895809218**
Chosen Option : **4**

Q.19 The question below has three items having certain relationship among them. The same relationship is expressed by sets of circles, each circle representing one item irrespective of its size. Match the items with right set of circles.

Apples, Mangoes, Oranges

Ans

✗ 1. 

✗ 2. 

✗ 3. 

✓ 4. 

Question ID : **9895809222**
Chosen Option : **4**

Q.20 Select the correct option that will fill in the blank and complete the series.

MaN, SaH, YaB, _____

Ans

✓ 1. EaV

✗ 2. RaC

✗ 3. TaD

Career Aglasem

Career Aglasem

✗ 4. FaV

Question ID : **9895809198**
Chosen Option : **2**

Q.21 In a certain code, DHONI is written as AELKF. How is EXPOSE written in that code?

Ans
✓ 1. BUMLPB
✗ 2. BUNLPB
✗ 3. BUMLQB
✗ 4. BVMLPB

Question ID : **9895809204**
Chosen Option : **2**

Q.22 Five chairs C1, C2, C3, C4 and C5 are placed one above the other. If C1 is above C2, C3 is above C4 but below C5 and C4 is above C1, which chair is in the middle?

Ans
✗ 1. C1
✗ 2. C2
✗ 3. C3
✓ 4. C4

Question ID : **9895809207**
Chosen Option : **4**

Q.23 A piece of paper is folded and cut as shown below in the question figures. From the given answer figures, how will it appear when opened?

Question figure



Ans
✗ 1. 
✓ 2. 
✗ 3. 
✗ 4. 

Question ID : **9895809221**
Chosen Option : **3**

Q.24 Four letter clusters have been given out of which three are alike in some manner, while one is different. Choose the odd one.

Ans
✗ 1. QSW
✗ 2. LNR
✗ 3. FHL
✓ 4. NPR

Question ID : **9895809199**
Chosen Option : **2**

Q.25 If 'P' means 'subtracted from', 'X' means 'multiplied by', 'Y' means 'added to', and 'Z' means 'Divided by', then:

54 Z 3 Y 22 X 5 = ?

Ans
1. 135 ✗
2. 128 ✓
3. 110 ✗
4. 144 ✗

Question ID : **9895809216**
Chosen Option : **2**

Q.26 Each water molecule, contains _____ hydrogen atoms and one Oxygen atom.

Ans
1. Two ✓
2. Three ✗
3. One ✗
4. Four ✗

Question ID : **9895808532**
Chosen Option : **1**

Q.27 Which type of soil develops deep cracks during hot weather?

Ans
1. Yellow soil ✗
2. Laterite soil ✗
3. Alluvial soil ✗
4. Black soil ✓

Question ID : **9895808534**
Chosen Option : **4**

Q.28 Pashmina is a fine type of wool which were first woven in which state of India?

Ans
1. Uttar Pradesh ✗
2. Punjab ✗
3. Jammu & Kashmir ✓
4. Himachal Pradesh ✗

Question ID : **9895808517**
Chosen Option : **2**

Q.29 Who was the president of Muslim League in 1930?

Ans
1. Muhammad Iqbal ✓
2. Syed Ahmed Khan ✗
3. Muhammad Ali Jinnah ✗
4. Shaukat Ali ✗

Question ID : **9895808539**
Chosen Option : **3**

Q.30 Which of the following cartoonist is best known for his creation of common man?

Ans
1. Shekhar Gurera ✗

Career Aglasem

Career Aglasem

2. Sudhir Tailang
3. Kutty
4. R.K. Laxman

Question ID : **9895808521**
Chosen Option : **3**

Q.31 Which village has shown that it is possible to reverse land degradation?

Ans
1. Bhandardara
2. Majuli
3. Katarmal
4. Sukhomajri

Question ID : **9895808535**
Chosen Option : **3**

Q.32 Which was the first Indian Satellite named after Indian mathematician launched in 1975 by the Soviet Union?

Ans
1. INSAt 1A
2. Bhaskara Sega-I
3. Rohini RS-D1
4. Aryabhata

Question ID : **9895808531**
Chosen Option : **3**

Q.33 In which year did the Khilafat Movement start?

Ans
1. 1922
2. 1923
3. 1920
4. 1921

Question ID : **9895808538**
Chosen Option : **2**

Q.34 The Gateway of India is located in:

Ans
1. Kolkata
2. Delhi
3. Mumbai
4. Bengaluru

Question ID : **9895808516**
Chosen Option : **3**

Q.35 The Bhoodan – Gramdan movement was initiated by:

Ans
1. Maneka Gandhi
2. Medha Patkar
3. Vinoba Bhave

Career Aglasem

✗ 4. Baba Amte

Question ID : **9895808536**
Chosen Option : **3**

Q.36 Which of the following is a popular name of bio gas?

Ans
✗ 1. Uranium
✗ 2. Petroleum
✓ 3. Gobar gas
✗ 4. Coal

Question ID : **9895808533**
Chosen Option : **2**

Q.37 Which of the following is a non-constitutional body of India?

Ans
✗ 1. Finance Commission
✓ 2. State Human Right Commission
✗ 3. National Commission
✗ 4. Election Commission

Question ID : **9895808526**
Chosen Option : **4**

Q.38 Which dam is built on the Narmada River?

Ans
✗ 1. Adhia Dam
✗ 2. Hirakud Dam
✓ 3. Sardar Sarovar Dam
✗ 4. Tehri Dam

Question ID : **9895808529**
Chosen Option : **3**

Q.39 In which colour is a solar cooker painted from the outside?

Ans
✗ 1. Green
✗ 2. Blue
✓ 3. Black
✗ 4. Red

Question ID : **9895808530**
Chosen Option : **2**

Q.40 Which state has the highest per capita income as per year 2017-18?

Ans
✗ 1. Mizoram
✗ 2. Bihar
✓ 3. Maharashtra
✗ 4. Kerala

Question ID : **9895808524**
Chosen Option : **3**

Q.41 In which Indian state is Dabu printing practiced, which involves applying earth in delicate patterns to cloth and then dipping in dye?

Ans
✔ 1. Rajasthan
✘ 2. Orissa
✘ 3. Andhra Pradesh
✘ 4. Assam

Question ID : **9895808515**
Chosen Option : **3**

Q.42 Viswanathan Anand was awarded the Padma Vibushan award in which year?

Ans
✘ 1. 2011
✔ 2. 2008
✘ 3. 2010
✘ 4. 2009

Question ID : **9895808522**
Chosen Option : **3**

Q.43 Which of the following terms in our preamble means behaving as if we are members of the same family?

Ans
✘ 1. Justice
✘ 2. Democracy
✔ 3. Fraternity
✘ 4. Equality

Question ID : **9895808527**
Chosen Option : **3**

Q.44 'Gella-Chutt' is an indigenous game associated with the state of:

Ans
✘ 1. Mizoram
✘ 2. Assam
✔ 3. Tripura
✘ 4. Arunachal Pradesh

Question ID : **9895808518**
Chosen Option : **3**

Q.45 Changing party allegiance from the party with which a person got elected to a different party is called:

Ans
✔ 1. defection
✘ 2. separation
✘ 3. party whip
✘ 4. alliance building

Question ID : **9895808528**
Chosen Option : **3**

Q.46 Identify the neighbouring country which has been performing better in terms of human development than India.

Career Aglasem

Ans
✗ 1. Bangladesh
✗ 2. Nepal
✓ 3. Sri Lanka
✗ 4. Pakistan

Question ID : **9895808525**
Chosen Option : **2**

Q.47 The book 'Wings of Fire' is authored by:

Ans
✗ 1. Salman Rushdie
✓ 2. A.P.J Abdul Kalam
✗ 3. R.K Narayan
✗ 4. Vikram Seth

Question ID : **9895808520**
Chosen Option : **2**

Q.48 In which year was the Rural Employment Generation Programme launched?

Ans
✗ 1. 1993
✓ 2. 1995
✗ 3. 1992
✗ 4. 1994

Question ID : **9895808523**
Chosen Option : **3**

Q.49 Who won the gold medal at Women's National Boxing Championships in 2019?

Ans
✗ 1. Ragini Upadhyay
✗ 2. Nikhat Zareen
✓ 3. Manju Rani
✗ 4. Pinki Rani Jangra

Question ID : **9895808519**
Chosen Option : **3**

Q.50 The rajas of the Mahajanpadas built forts as they provided _____.

Ans
✗ 1. Mutability
✓ 2. Security
✗ 3. Marketability
✗ 4. Transportability

Question ID : **9895808537**
Chosen Option : **3**

Q.51

Career Aglasem

DIRECTION: The population of a city is 8000. They have various types of occupation which is given below by the pie-chart. Study the pie-chart and answer the given questions.

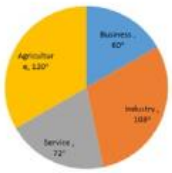

How much percent are in service sector from the total population?

Ans
✗ 1. 36%
✓ 2. 20%
✗ 3. 72%
✗ 4. 25%

Question ID : **9895808966**
Chosen Option : **1**

Q.52 The ratio between two numbers is 7 : 16. If the second number is 256 then the first number is:

Ans
✗ 1. 120
✗ 2. 156
✓ 3. 112
✗ 4. 144

Question ID : **9895808953**
Chosen Option : **1**

Q.53 30 persons can do a piece of work in 24 days. How many more people are required to complete the work in 20 days?

Ans
✗ 1. 8
✗ 2. 5
✗ 3. 4
✓ 4. 6

Question ID : **9895808958**
Chosen Option : **3**

Q.54 What is the arithmetic mean of first 8 multiples of 13?

Ans
✗ 1. 55.4
✓ 2. 58.5
✗ 3. 72.5
✗ 4. 61.8

Question ID : **9895808949**
Chosen Option : **1**

Q.55 If $\frac{8x+3y}{4x+5y} = \frac{25}{23}$ then find x : y.

aglasem.com

Career Aglasem

Ans
✔ 1. 2 : 3
✘ 2. 2 : 5
✘ 3. 3 : 5
✘ 4. 1 : 5

Question ID : **9895808954**
Chosen Option : **1**

Q.56 **DIRECTION:** The population of a city is 8000. They have various types of occupation which is given below by the pie-chart. Study the pie-chart and answer the given questions.

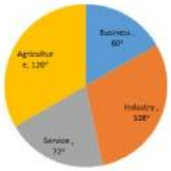

How much population percent is less in industry sector than in agriculture sector?

Ans
✔ 1. 10%
✘ 2. 25%
✘ 3. 15%
✘ 4. 20%

Question ID : **9895808967**
Chosen Option : **3**

Q.57 The marked price of an item is ₹ 900 but a retailer purchases it on 40% discount and sells it on ₹ 900. The percentage profit of the retailer is:

Ans
✘ 1. 60%
✘ 2. $68\frac{1}{3}\%$
✘ 3. 40%
✔ 4. $66\frac{2}{3}\%$

Question ID : **9895808948**
Chosen Option : **1**

Q.58 The average of 6 values is 11.2. If 3 is multiplied to each number then what will be the new average?

Ans
✘ 1. 22.6
✘ 2. 14.6
✘ 3. 18.6
✔ 4. 33.6

Question ID : **9895808947**
Chosen Option : **3**

Q.59 The speed of a boat in still water is 9 km/hr and the speed of stream is 3 km/hr. The difference between the upstream speed and downstream speed will be:

Career Aglasem

Ans
✔ 1. 6 km/hr
✗ 2. 5 km/hr
✗ 3. 3.5 km/hr
✗ 4. 7.5 km/hr

Question ID : **9895808961**
Chosen Option : **1**

Q.60 Two concentric circles with radii p cm and (p + 2) cm are drawn on a paper. The difference between their areas is 44 sq. cm
What is the value of p? (Take $\pi = \frac{22}{7}$)

Ans
✗ 1. 1.5
✗ 2. 5
✗ 3. 6
✔ 4. 2.5

Question ID : **9895808962**
Chosen Option : **3**

Q.61 $\frac{4}{7}$ of $\frac{8}{9} \div \frac{8}{7} \times 180$ of $\frac{1}{9} = ?$

Ans
✗ 1. $\frac{20}{9}$
✗ 2. $\frac{9}{20}$
✔ 3. $\frac{80}{9}$
✗ 4. $\frac{9}{80}$

Question ID : **9895808944**
Chosen Option : **3**

Q.62 If cost prices of 100 note books is same as selling price of 80 note books. What is the percent gain?

Ans
✗ 1. 15%
✗ 2. 30%
✔ 3. 25%
✗ 4. 20%

Question ID : **9895808952**
Chosen Option : **4**

Q.63 The amounts of ₹ 7500 at compound interest at 4% per annum for 2 years, is:

Ans
✗ 1. ₹ 8100
✗ 2. ₹ 8082
✗ 3. ₹ 7800
✔ 4. ₹ 8112

Career Aglasem

Question ID : **9895808957**
Chosen Option : **3**

Q.64 21% of a number is 546. What will be 89% of that number?

Ans

✗ 1. 900

✗ 2. 2116

✗ 3. 1200

✓ 4. 2314

Question ID : **9895808950**
Chosen Option : **4**

Q.65 A person bought an item and sold it at a loss of 5%. If he had bought it for 10% less and sold it for ₹ 170 more, he would have had a profit of 20%, Find the cost price of this item. (nearest to ₹ 1)

Ans

✗ 1. ₹ 1440

✓ 2. ₹ 1308

✗ 3. ₹ 1300

✗ 4. ₹ 1500

Question ID : **9895808951**
Chosen Option : **3**

Q.66 A pipe can fill a cistern in 20 minutes whereas the cistern when full can be emptied by a leak in 28 minutes. When both are opened, The time taken to fill the cistern is:

Ans

✗ 1. 80 min

✓ 2. 70 min

✗ 3. 60 min

✗ 4. 48 min

Question ID : **9895808959**
Chosen Option : **3**

Q.67 A certain sum amounts to ₹ 756 in 2 years and to ₹ 873 is $3\frac{1}{2}$ years at a certain rate of simple interest. The rate of interest per annum is:

Ans

✗ 1. 11%

✓ 2. 13%

✗ 3. 10%

✗ 4. 12%

Question ID : **9895808956**
Chosen Option : **3**

Q.68 A square with maximum possible side is drawn in a circle of radius 12 cm. What is the area of square?

Ans

✓ 1. 288 sq. cm

✗ 2. 72 sq. cm

✗ 3. 184 sq. cm

Career Aglasem

Career Aglasem

✗ 4. 276 sq. cm

Question ID : **9895808963**
Chosen Option : **3**

Q.69 Divide 500 into two parts such that the ratio of one to the other are in 5 : 3?

Ans
✓ 1. 312.5, 187.5
✗ 2. 308.5, 191.5
✗ 3. 280, 220
✗ 4. 300, 200

Question ID : **9895808955**
Chosen Option : **3**

Q.70 What value should come in place of the question mark (?) in the following questions?

$31 + 3 \times 15 = ?$

Ans
✗ 1. 180
✗ 2. 140
✗ 3. 165
✓ 4. 155

Question ID : **9895808945**
Chosen Option : **2**

Q.71 The speed of a ship in still water is 5 km/hr and the speed of the stream is 2 km/hr. Rohan rows to a place at a distance of 21 km and comes back to the starting point. The total time taken by him is:

Ans
✗ 1. 7.2 hours
✓ 2. 10 hours
✗ 3. 3.6 hours
✗ 4. 6 hours

Question ID : **9895808960**
Chosen Option : **1**

Q.72 What is the greatest number that will divide 209 and 347 leaving remainder 5 and 7 respectively?

Ans
✗ 1. 23
✗ 2. 16
✗ 3. 19
✓ 4. 17

Question ID : **9895808943**
Chosen Option : **3**

Q.73 The average of first 10 prime number is:

Ans
✗ 1. 13.1
✗ 2. 12.7

Career Aglasem

✔ 3. 12.9

✘ 4. 15.1

Question ID : **9895808946**
Chosen Option : **1**

Q.74 The area of the cardboard needed to make a closed box of size 10 cm × 15 cm × 8 cm will be:

Ans

✔ 1. 700 cm^2

✘ 2. 350 cm^2

✘ 3. 1000 cm^2

✘ 4. 1390 cm^2

Question ID : **9895808964**
Chosen Option : **3**

Q.75 **DIRECTION:** The population of a city is 8000. They have various types of occupation which is given below by the pie-chart. Study the pie-chart and answer the given questions.



The ratio of people working in service to industry sectors respectively:

Ans

✔ 1. 2 : 3

✘ 2. 3 : 5

✘ 3. 3 : 4

✘ 4. 5 : 3

Question ID : **9895808965**
Chosen Option : **3**

Section : **English Language**

Q.1 Select the wrongly spelt word.

Ans

✔ 1. Existance

✘ 2. Experience

✘ 3. Eminent

✘ 4. Explanation

Question ID : **9895809091**
Chosen Option : **--**

Q.2 Select the most appropriate word to fill in the blank.

A number of people _____ to watch the live performance last night.

Ans

✘ 1. gather

aglasem.com

Career Aglasem

✔ 2. has gathered

✘ 3. has been gathered

✘ 4. gathered

Question ID : **9895809074**
Chosen Option : --

Q.3 Select the antonym of the given word.

Diminish

Ans ✔ 1. Decrease

✘ 2. Divide

✘ 3. Increase

✘ 4. Reduce

Question ID : **9895809084**
Chosen Option : --

Q.4 Select the synonym of the given word.

ACCOMPLISH

Ans ✘ 1. Fail

✔ 2. Hinder

✘ 3. Lose

✘ 4. Achieve

Question ID : **9895809083**
Chosen Option : --

Q.5 Select the word which means the same as the group of words given.

A mass of snow, ice, and rocks falling rapidly down a mountainside

Ans ✘ 1. Glacier

✔ 2. Avalanche

✘ 3. Iceberg

✘ 4. Landslide

Question ID : **9895809089**
Chosen Option : --

Q.6 Select the meaning of the given idiom.

Under a cloud

Ans ✘ 1. under observation

✘ 2. enjoying favorable luck

✔ 3. experiencing cloudy weather

✘ 4. under suspicion

aglasem.com

Career Aglasem

Question ID : **9895809087**
Chosen Option : --

Q.7 Select the meaning of the given idiom.

Get a kick out of

Ans
✔ 1. Give up something
✗ 2. Enjoy something
✗ 3. Kick something
✗ 4. Predict something

Question ID : **9895809086**
Chosen Option : --

Comprehension:

In the following passage some words have been deleted. Fill in the blanks with the help of the alternatives given. Select the most appropriate option for each number.

An Italian town is offering to pay people up to €2000 to move there. The Mayor of the town has made the (1) _____ in the hope of reversing (2) _____ town's declining population. The population (3) _____ small towns of Italy (4) _____ to the big cities leaving (5) _____ only the aged people. Some towns have been left with as little as twelve residents.

SubQuestion No : 8

Q.8 Select the most appropriate option that will fill in the blank number 1.

Ans
✗ 1. present
✗ 2. offer
✗ 3. reward
✔ 4. gift

Question ID : **9895809077**
Chosen Option : --

Comprehension:

In the following passage some words have been deleted. Fill in the blanks with the help of the alternatives given. Select the most appropriate option for each number.

An Italian town is offering to pay people up to €2000 to move there. The Mayor of the town has made the (1) _____ in the hope of reversing (2) _____ town's declining population. The population (3) _____ small towns of Italy (4) _____ to the big cities leaving (5) _____ only the aged people. Some towns have been left with as little as twelve residents.

SubQuestion No : 9

Q.9 Select the most appropriate option that will fill in the blank number 2.

Ans
1. some
2. one
3. a
4. the

Question ID : **9895809078**
Chosen Option : --

Comprehension:

In the following passage some words have been deleted. Fill in the blanks with the help of the alternatives given. Select the most appropriate option for each number.

An Italian town is offering to pay people up to €2000 to move there. The Mayor of the town has made the (1) _____ in the hope of reversing (2) _____ town's declining population. The population (3) _____ small towns of Italy (4) _____ to the big cities leaving (5) _____ only the aged people. Some towns have been left with as little as twelve residents.

SubQuestion No : 10

Q.10 Select the most appropriate option that will fill in the blank number 3.

Ans
1. at
2. between
3. from
4. among

Question ID : **9895809079**
Chosen Option : --

Comprehension:

In the following passage some words have been deleted. Fill in the blanks with the help of the alternatives given. Select the most appropriate option for each number.

An Italian town is offering to pay people up to €2000 to move there. The Mayor of the town has made the (1) _____ in the hope of reversing (2) _____ town's declining population. The population (3) _____ small towns of Italy (4) _____ to the big cities leaving (5) _____ only the aged people. Some towns have been left with as little as twelve residents.

SubQuestion No : 11

Q.11 Select the most appropriate option that will fill in the blank number 4.

Ans
1. transported
2. migrated
3. transferred

Career Aglasem

Career Aglasem

✗ 4. immigrated

Question ID : **9895809080**
Chosen Option : --

Comprehension:

In the following passage some words have been deleted. Fill in the blanks with the help of the alternatives given. Select the most appropriate option for each number.

An Italian town is offering to pay people up to €2000 to move there. The Mayor of the town has made the (1) _____ in the hope of reversing (2) _____ town's declining population. The population (3) _____ small towns of Italy (4) _____ to the big cities leaving (5) _____ only the aged people. Some towns have been left with as little as twelve residents.

SubQuestion No : 12

Q.12 Select the most appropriate option that will fill in the blank number 5.

Ans
✗ 1. beyond
✗ 2. below
✗ 3. behind
✔ 4. before

Question ID : **9895809081**
Chosen Option : --

Q.13 Select the antonym of the given word.

CONVICTED

Ans
✗ 1. Alleged
✔ 2. Blamed
✗ 3. Acquitted
✗ 4. Charged

Question ID : **9895809085**
Chosen Option : --

Q.14 Select the wrongly spelt word.

Ans
✗ 1. Encouragment
✗ 2. Questionnaire
✔ 3. Environment
✗ 4. Performance

Question ID : **9895809090**
Chosen Option : --

Q.15

Select the most appropriate option to substitute the underlined segment in the given sentence. If there is no need to substitute it, select No substitution required.

The escalator at the railway station is working again, thanks to the effort for our technicians.

Ans
1. efforts of our technicians
2. No substitution required
3. efforts make by our technicians
4. efforts from our technicians

Question ID : **9895809071**
Chosen Option : --

Q.16 Select the most appropriate word to fill in the blank.

The bear didn't attack the lady because he was afraid _____ her.

Ans
1. at
2. of
3. from
4. for

Question ID : **9895809075**
Chosen Option : --

Q.17 Select the synonym of the given word.

APPARENT

Ans
1. Hidden
2. Obvious
3. Latent
4. Concealed

Question ID : **9895809082**
Chosen Option : --

Q.18 Select the most appropriate option to substitute the underlined segment in the given sentence. If there is no need to substitute it, select No substitution required.

Last month, scientists are posting the latest pictures of Mars taken by the Mangalyaan.

Ans
1. No substitution required
2. posted
3. have been posting
4. will be posting

Question ID : **9895809072**
Chosen Option : --

Q.19 Select the most appropriate word to fill in the blank.

He was _____ from jail only last month.

Ans

Career Aglasem

Career Aglasem

✗ 1. imprisoned

✗ 2. released

✗ 3. arrested

✓ 4. sent

Question ID : **9895809092**
Chosen Option : --

Q.20 Identify the segment in the sentence which contains the grammatical error from the given options.

Before the President can start his speech, he was interrupted by his secretary.

Ans

✗ 1. by his secretary

✗ 2. can start

✓ 3. Before the

✗ 4. was interrupted

Question ID : **9895809069**
Chosen Option : --

Q.21 Select the most appropriate option to substitute the underlined segment in the given sentence. If there is no need to substitute it, select No substitution required.

His grandfather finds a tiny tiger-cub in the forest and brought him home.

Ans

✓ 1. bringing home

✗ 2. No substitution required

✗ 3. brings him home

✗ 4. has bring home

Question ID : **9895809073**
Chosen Option : --

Q.22 Select the most appropriate word to fill in the blank.

His proposal was not _____ to me.

Ans

✗ 1. accessible

✗ 2. acceptable

✓ 3. adapted

✗ 4. apparent

Question ID : **9895809093**
Chosen Option : --

Q.23 Select the word which means the same as the group of words given.

One who loves mankind

Ans

✓ 1. Philanthropist

✗ 2. Misogamist

Career Aglasem

✗ 3. Misanthropist

✗ 4. Misogynist

Question ID : **9895809088**
Chosen Option : **--**

Q.24 Identify the segment in the sentence which contains the grammatical error from the given options.

The question that there is life on other planets baffles scientists.

Ans
✔ 1. The question that

✗ 2. there is life

✗ 3. baffles scientists

✗ 4. on other planets

Question ID : **9895809068**
Chosen Option : **--**

Q.25 Identify the segment in the sentence which contains the grammatical error from the given options.

The day he won the Grammy Award was red letter day in the singer's life.

Ans
✗ 1. in the singer's life.

✗ 2. he won

✔ 3. The day

✗ 4. was red letter day

Question ID : **9895809070**
Chosen Option : **--**

Section : **Hindi Language**

Q.1 'हाथ से लिखा हुआ' शब्द समूह के लिए एक शब्द है-

Ans
✗ 1. हस्तलाघव

✗ 2. निम्नलिखित

✔ 3. हस्तक्षेप

✗ 4. हस्तलिखित

Question ID : **9895807043**
Chosen Option : **--**

Q.2 रिक्त स्थान को भरने के लिए उपयुक्त शब्द का चयन करें।

राम के _____ आग्रह करने पर मैं उसके घर गया।

Ans
✗ 1. अधिक

✔ 2. तीव्र

✗ 3. नरम

✗ 4. बहु

Question ID : **9895807027**
Chosen Option : --

Q.3 'भौतिक' का विलोम है-

Ans
✗ 1. अलौकिक
✗ 2. अभद्र
✓ 3. भविष्य
✗ 4. आध्यात्मिक

Question ID : **9895807038**
Chosen Option : --

Q.4 सही वर्तनी वाले शब्द का चयन करें।

Ans
✗ 1. उपरूक्त
✗ 2. उपर्योक्त
✗ 3. उपर्युक्त
✓ 4. उर्पयुक्त

Question ID : **9895807046**
Chosen Option : --

Q.5 दिए गए वाक्य में रेखांकित खंड को प्रतिस्थापित करने के लिए उपयुक्त विकल्प का चयन करें।

सविता पढ़ना-लिखना जानती है।

Ans
✗ 1. अपढ़
✓ 2. निरक्षर
✗ 3. साक्षर
✗ 4. स्वार्थी

Question ID : **9895807025**
Chosen Option : --

Comprehension:

निम्नलिखित गद्यांश के रिक्त स्थानों की पूर्ति गद्यांश के नीचे दिए गए प्रश्नों के अनुसार कीजिए-

डिजिटल इंडिया में डेटा का डिजिटलाईजेशन आसानी से होगा जो आगे चलकर चीजों को तेज और ज्यादा मजबूत बनाने में _____ (1) होगा। यह कागजी कार्य, समय और मानव श्रम की भी _____ (2) करेगा। सरकार और निजी क्षेत्र के बीच गठबंधन के द्वारा यह प्रोजेक्ट गति _____ (3)। तेज गति नेटवर्क के साथ आपस में जुड़े हुए गाँव बड़े _____ (4) से गुजरेंगे। भारत में सभी शहर, नगर और गाँव _____ (5) तकनीकी होंगे।

SubQuestion No : 6

Q.6

Career Aglasem

गद्यांश में संकेतित रिक्त स्थान (1) के लिए उपयुक्त शब्द होगा।

Ans
✗ 1. विभाजक
✗ 2. सहायक
✗ 3. रोधक
✓ 4. बाधक

Question ID : **9895807032**
Chosen Option : --

Comprehension:

निम्नलिखित गद्यांश के रिक्त स्थानों की पूर्ति गद्यांश के नीचे दिए गए प्रश्नों के अनुसार कीजिए-

डिजिटल इंडिया में डेटा का डिजिटलाईजेशन आसानी से होगा जो आगे चलकर चीजों को तेज और ज्यादा मजबूत बनाने में _____ (1) होगा। यह कागजी कार्य, समय और मानव श्रम की भी _____ (2) करेगा। सरकार और निजी क्षेत्र के बीच गठबंधन के द्वारा यह प्रोजेक्ट गति _____ (3)। तेज गति नेटवर्क के साथ आपस में जुड़े हुए गाँव बड़े _____ (4) से गुजरेंगे। भारत में सभी शहर, नगर और गाँव _____ (5) तकनीकी होंगे।

SubQuestion No : 7

Q.7 गद्यांश में संकेतित रिक्त स्थान (2) के लिए उपयुक्त शब्द होगा।

Ans
✗ 1. आय
✗ 2. हानि
✗ 3. बचत
✓ 4. व्यय

Question ID : **9895807033**
Chosen Option : --

Comprehension:

निम्नलिखित गद्यांश के रिक्त स्थानों की पूर्ति गद्यांश के नीचे दिए गए प्रश्नों के अनुसार कीजिए-

डिजिटल इंडिया में डेटा का डिजिटलाईजेशन आसानी से होगा जो आगे चलकर चीजों को तेज और ज्यादा मजबूत बनाने में _____ (1) होगा। यह कागजी कार्य, समय और मानव श्रम की भी _____ (2) करेगा। सरकार और निजी क्षेत्र के बीच गठबंधन के द्वारा यह प्रोजेक्ट गति _____ (3)। तेज गति नेटवर्क के साथ आपस में जुड़े हुए गाँव बड़े _____ (4) से गुजरेंगे। भारत में सभी शहर, नगर और गाँव _____ (5) तकनीकी होंगे।

SubQuestion No : 8

Career Aglasem

Q.8 गद्यांश में संकेतित रिक्त स्थान (3) के लिए उपयुक्त शब्द होगा।

Ans
✗ 1. दौड़ेगा
✗ 2. पकड़ेगा
✓ 3. चलेगा
✗ 4. रोकेगा

Question ID : **9895807034**
Chosen Option : --

Comprehension:

निम्नलिखित गद्यांश के रिक्त स्थानों की पूर्ति गद्यांश के नीचे दिए गए प्रश्नों के अनुसार कीजिए-

डिजिटल इंडिया में डेटा का डिजिटलाईजेशन आसानी से होगा जो आगे चलकर चीजों को तेज और ज्यादा मजबूत बनाने में _____ (1) होगा। यह कागजी कार्य, समय और मानव श्रम की भी _____ (2) करेगा। सरकार और निजी क्षेत्र के बीच गठबंधन के द्वारा यह प्रोजेक्ट गति _____ (3)। तेज गति नेटवर्क के साथ आपस में जुड़े हुए गाँव बड़े _____ (4) से गुजरेंगे। भारत में सभी शहर, नगर और गाँव _____ (5) तकनीकी होंगे।

SubQuestion No : 9

Q.9 गद्यांश में संकेतित रिक्त स्थान (4) के लिए उपयुक्त शब्द होगा।

Ans
✗ 1. लगाव
✓ 2. बदलाव
✗ 3. सुझाव
✗ 4. चुनाव

Question ID : **9895807035**
Chosen Option : --

Comprehension:

निम्नलिखित गद्यांश के रिक्त स्थानों की पूर्ति गद्यांश के नीचे दिए गए प्रश्नों के अनुसार कीजिए-

डिजिटल इंडिया में डेटा का डिजिटलाईजेशन आसानी से होगा जो आगे चलकर चीजों को तेज और ज्यादा मजबूत बनाने में _____ (1) होगा। यह कागजी कार्य, समय और मानव श्रम की भी _____ (2) करेगा। सरकार और निजी क्षेत्र के बीच गठबंधन के द्वारा यह प्रोजेक्ट गति _____ (3)। तेज गति नेटवर्क के साथ आपस में जुड़े हुए गाँव बड़े _____ (4) से गुजरेंगे। भारत में सभी शहर, नगर और गाँव _____ (5) तकनीकी होंगे।

Career Aglasem

SubQuestion No : 10

Q.10 गद्यांश में संकेतित रिक्त स्थान (5) के लिए उपयुक्त शब्द होगा।

Ans
✗ 1. ज्यादा
✗ 2. बड़ी
✗ 3. भारी
✔ 4. कम

Question ID : **9895807036**
Chosen Option : --

Q.11 दिए गए वाक्य का वह भाग ज्ञात करें जिसमें कोई त्रुटि है।

किसी का आचरण वायु के झोंके से हिल नहीं सकती हैं।

Ans
✗ 1. सकती हैं।
✗ 2. हिल नहीं
✗ 3. वायु के झोंके से
✔ 4. किसी का आचरण

Question ID : **9895807021**
Chosen Option : --

Q.12 दिए गए वाक्य का वह भाग ज्ञात करें जिसमें कोई त्रुटि है।

दुनिया में अनेक प्रकार के छल प्रपंचों का सूत्रपात हुई।

Ans
✗ 1. सूत्रपात हुई।
✗ 2. अनेक प्रकार के
✔ 3. दुनिया में
✗ 4. छल प्रपंचों का

Question ID : **9895807023**
Chosen Option : --

Q.13 'जिसे कठिनाई से जीता जा सके' के लिए एक शब्द प्रयुक्त होता है-

Ans
✗ 1. अज्ञेय
✗ 2. अजेय
✗ 3. दुर्जेय
✔ 4. विजित

Question ID : **9895807044**
Chosen Option : --

Q.14

Career Aglasem

'गूलर का फूल होना' मुहावरे का अर्थ है-

Ans
✔ 1. दुर्लभ होना
✗ 2. अमीर होना
✗ 3. सुलभ होना
✗ 4. हीन होना

Question ID : **9895807041**
Chosen Option : --

Q.15 दिए गए वाक्य में रेखांकित खंड को प्रतिस्थापित करने के लिए उपयुक्त विकल्प का चयन करें।

विद्यापति के पद गाए जा सकते हैं।

Ans
✗ 1. पेय
✗ 2. प्रदेय
✗ 3. गोपनीय
✔ 4. गेय

Question ID : **9895807024**
Chosen Option : --

Q.16 'पत्नी' का पर्याय शब्द है-

Ans
✗ 1. ललना
✗ 2. भार्या
✔ 3. कामिनी
✗ 4. महिला

Question ID : **9895807040**
Chosen Option : --

Q.17 सही वर्तनी वाले शब्द का चयन करें।

Ans
✗ 1. विषाद
✗ 2. विशाद
✗ 3. वीषाद
✔ 4. विसाद

Question ID : **9895807045**
Chosen Option : --

Q.18 दिए गए वाक्य में रेखांकित खंड को प्रतिस्थापित करने के लिए उपयुक्त विकल्प का चयन करें।

धर्म के कामों में सहयोग करना चाहिए।

Ans
✗ 1. धर्मवान
✔ 2. धार्मिक
✗ 3. धर्मीय

Career Aglasem

✗ 4. धर्मी

Question ID : **9895807026**
Chosen Option : --

Q.19 'त्याग' का विलोम शब्द है-

Ans
✗ 1. ग्रहण
✓ 2. परित्याग
✗ 3. अनिश्चित
✗ 4. विग्रह

Question ID : **9895807037**
Chosen Option : --

Q.20 दिए गए वाक्य का वह भाग ज्ञात करें जिसमें कोई त्रुटि है।

इस नश्वर संसार के भोग विलास का सामग्रियाँ भी क्षणभंगुर हैं।

Ans
✓ 1. इस नश्वर
✗ 2. भोग विलास का सामग्रियाँ भी
✗ 3. क्षणभंगुर हैं।
✗ 4. संसार के

Question ID : **9895807022**
Chosen Option : --

Q.21 रिक्त स्थान को भरने के लिए उपयुक्त शब्द का चयन करें।

दिल्ली से अनेक पत्रों और पत्रिकाओं का _____ होता है।

Ans
✓ 1. प्रकाशन
✗ 2. निर्माण
✗ 3. निकलता
✗ 4. बनना

Question ID : **9895807030**
Chosen Option : --

Q.22 'होम कर देना' मुहावरे का अर्थ है-

Ans
✗ 1. शंकित करना
✓ 2. नष्ट कर देना
✗ 3. आश्चर्य चकित कर देना
✗ 4. हवन करना

Question ID : **9895807042**
Chosen Option : --

Q.2

Career Aglasem

3 'नदी' का पर्यायवाची शब्द है-

Ans
✗ 1. निर्झरिणी
✓ 2. तालाब
✗ 3. सर
✗ 4. तड़ाग

Question ID : **9895807039**
Chosen Option : --

Q.24 रिक्त स्थान को भरने के लिए उपयुक्त शब्द का चयन करें।

उसकी बुद्धि बड़ी _____ है।

Ans
✗ 1. विकृति
✗ 2. विशाल
✗ 3. बुद्धिमान
✓ 4. सूक्ष्म

Question ID : **9895807028**
Chosen Option : --

Q.25 रिक्त स्थान को भरने के लिए उपयुक्त शब्द का चयन करें।

साहित्य और जीवन का _____ संबंध है।

Ans
✓ 1. घोर
✗ 2. पक्का
✗ 3. प्रगाढ़
✗ 4. मजबूत

Question ID : **9895807029**
Chosen Option : --

Career Aglasem