Career Aglasem

Constable (GD) in CAPFs, NIA, SSF and Rifleman (GD) in Assam Rifles Examination, 2018

Roll No. :	[redacted]
Registration No.	
Name :	
Exam Venue :	
Exam Time :	4:00 PM - 5:30 PM
Exam Date :	03/03/2019

Section : **General Section**

Q.1 Select the option that is related to the third term in the same way as the first term is related to the second term.

35 : 15 : : 72 : ?

Ans
✔ 1. 14
✘ 2. 54
✘ 3. 27
✘ 4. 15

Question ID : **9895808354**
Chosen Option : **2**

Q.2 Select the related word pair from the given alternatives.

India : Rupee : : _____ : _____

Ans
✘ 1. South Africa : Pound
✘ 2. Switzerland : Euro
✔ 3. Russia : Ruble
✘ 4. China : Yen

Question ID : **9895808343**
Chosen Option : **2**

Q.3 Select the correct option that will fill in the blank and complete the series.

145, 100, 65, 40, ?

Ans
✔ 1. 25
✘ 2. 10
✘ 3. 20
✘ 4. 15

Question ID : **9895808352**
Chosen Option : **1**

Q.4 Select the correct option that will fill in the blank and complete the series.

2, 8, 32, 128, 512, ?

Ans
✘ 1. 2067
✔ 2. 2048

✗ 3. 2507

✗ 4. 2536

Question ID : **9895808353**
Chosen Option : **2**

Q.5 A piece of paper is folded and cut as shown in the question figures. From the given figures, indicate how it will appear when opened?

Question figures:

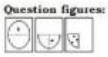

Ans

✗ 1. 

✓ 2. 

✗ 3. 

✗ 4. 

Question ID : **9895808362**
Chosen Option : **2**

Q.6 Five monkeys A, B, C, D and E are sitting on a branch of a tree.
C is sitting next to D. D is not sitting with E. E is on the left end of the branch. C is on second position from right. A is immediate right of B and B is on the right side of E. A and C are sitting together.
Who is sitting at the centre?

Ans

✗ 1. D

✓ 2. A

✗ 3. C

✗ 4. B

Question ID : **9895808347**
Chosen Option : **2**

Q.7 The statements below are followed by two conclusions labeled I and II. Assuming that the information in the statements is true, even if it appears to be at variance with generally established facts, decide which conclusion(s) logically and definitely follow(s) from the information given in the statements.

Statements:

Some scooters are planes.
Some planes are dogs.
Some dogs are plants.

Conclusions:

I. Some plants are scooters.
II. No plane is scooter.

Ans

✗ 1. Only Conclusion I follows.

✗ 2. Only Conclusion II follows.

✓ 3. Neither Conclusion I nor II follows.

✗ 4. Either Conclusion I or II follows.

Question ID : **9895808351**
Chosen Option : **3**

Q.8 Find the missing number from the below options.

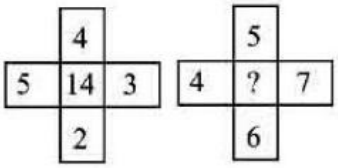

Ans
✔ 1. 4
✘ 2. 6
✘ 3. 7
✘ 4. 3

Question ID : **9895808356**
Chosen Option : **4**

Q.9 X, Y, Z, P, Q and R are sitting in a row facing north. X is the neighbour of Y and P. Q is the neighbour of Z and R, P is to the right of X and P and Z are immediate neighbours.

Which pair sits on the extreme ends?

Ans
✘ 1. P,Z
✘ 2. Y,P
✘ 3. X,P
✔ 4. Y,R

Question ID : **9895808348**
Chosen Option : **4**

Q.10 Select the option that is related to the third term in the same way as the first term is related to the second term.

Hand : Finger : : Leg : _____

Ans
✘ 1. Heel
✘ 2. Walk
✘ 3. Knee
✔ 4. Toes

Question ID : **9895808342**
Chosen Option : **4**

Q.11 Identify the two figures from the following set of figures which are out of position and require interchange of positions to put the entire series in order.

Problem Figure

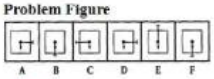

Ans
✘ 1. (D & F)
✔ 2. (D & E)
✘ 3. (A & C)
✘ 4. (B & D)

Question ID : **9895808358**
Chosen Option : **2**

Q.12

aglasem.com

Career Aglasem

2 If a mirror is placed on the line MN, then which of the answer figures is the right image of the given figure?

Question Figure:



Ans

✔ 1. 

✘ 2. 

✘ 3. 

✘ 4. 

Question ID : **9895808361**
Chosen Option : **1**

Q.13 Study the following Venn-diagram and answer the given question.

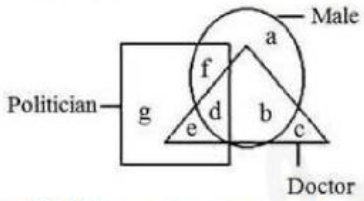

Which letter represents a male politician only?

Ans
✘ 1. d
✘ 2. b
✘ 3. e
✔ 4. f

Question ID : **9895808363**
Chosen Option : **4**

Q.14 Select the correct option that will fill in the blank and complete the series.

WVU, RQP, MLK, ?

Ans
✘ 1. HGI
✘ 2. IGF
✔ 3. HGF
✘ 4. JHI

Question ID : **9895808339**
Chosen Option : **3**

Q.15 In a certain code, ANIMAL is coded as INALAM, then how is SAMPLE coded in the same way?

Ans
✔ 1. MASELP

Career Aglasem

✗ 2. MSALEP
✗ 3. MALESP
✗ 4. ASMALE

Question ID : **9895808345**
Chosen Option : **1**

Q.16 The statements below are followed by two conclusions labeled I and II. Assuming that the information in the statements is true, even if it appears to be at variance with generally established facts, decide which conclusion(s) logically and definitely follow(s) from the information given in the statements.

Statements:

All kids are Adults.
Some Adults are old.

Conclusion:

I. All old are kids.
II. Some kids are old.

Ans
✓ 1. Neither conclusion I nor II follows
✗ 2. Either conclusion I or II follows
✗ 3. Only conclusion II follows
✗ 4. Only conclusion I follows

Question ID : **9895808350**
Chosen Option : **2**

Q.17 Choose the option figure in which the problem figure is hidden/embedded.

Questions Figure:



Ans
✓ 1. 
✗ 2. 
✗ 3. 
✗ 4. 

Question ID : **9895808360**
Chosen Option : **1**

Q.18 Four options have been given out of which three are alike in some manner, while one is different. Choose the odd one.

Ans
✗ 1. 473
✓ 2. 287
✗ 3. 693
✗ 4. 385

Question ID : **9895808355**

Career Aglasem

Chosen Option : **2**

Q.19 Four letter clusters have been given out of which three are alike in some manner, while one is different. Choose the odd one.

Ans

✗ 1. HMR

✗ 2. JOT

✗ 3. INS

✔ 4. DLT

Question ID : **9895808340**
Chosen Option : **4**

Q.20 In a class of 45 students, a boy is ranked 20th. When two boys joined, his rank was dropped by one. What is his new rank from the end?

Ans

✗ 1. 25th

✔ 2. 27th

✗ 3. 28th

✗ 4. 26th

Question ID : **9895808349**
Chosen Option : **2**

Q.21 Which of the following answer figure will complete the given figure?

Question figure:

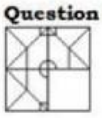

Ans

✗ 1. 

✔ 2. 

✗ 3. 

✗ 4. 

Question ID : **9895808359**
Chosen Option : **2**

Q.22 Four words have been given out of which three are alike in some manner, while one is different. Choose the odd one.

Ans

✗ 1. Kuchipudi

✔ 2. Hemis

✗ 3. Kathakali

✗ 4. Sattriya

Question ID : **9895808341**
Chosen Option : **2**

Career Aglasem

Q.23 If SENSIBLE is written as 10 and SAMUELS as 9, how will NADAL be written?

Ans
1. 11 ✗
2. 4 ✗
3. 9 ✗
4. 7 ✓

Question ID : **9895808346**
Chosen Option : **4**

Q.24 Select the option that is related to the third term in the same way as the first term is related to the second term.

AFK : EJO : : PUZ : ?

Ans
1. UOM ✗
2. USC ✗
3. TXE ✗
4. TYD ✓

Question ID : **9895808344**
Chosen Option : **4**

Q.25 Select the correct combination of mathematical signs to replace '*' signs and to balance the given equation:

78 * 3 * 4 * 36 * 140

Ans
1. + + + = ✗
2. − + × = ✗
3. ÷ × − = ✗
4. ÷ × + = ✓

Question ID : **9895808357**
Chosen Option : **4**

Q.26 Name the devotional folk music of Manipur usually sung by a group of people.

Ans
1. Gha To Kito ✗
2. Khubak eshei ✓
3. Banvarh ✗
4. Domkach ✗

Question ID : **9895807403**
Chosen Option : **1**

Q.27 Who won the 2018 French Open Men's Tennis?

Ans
1. Andy Murray ✗
2. Novak Djokovic ✗
3. Rafael Nadal ✓
4. Roger Federer ✗

Question ID : **9895807407**
Chosen Option : **2**

Q.28 The harvest festival, Puthari is celebrated by which tribes?

Ans

Career Aglasem

1. Garo
2. Angami
3. Kodava
4. Monpa

Question ID : **9895807404**
Chosen Option : **2**

Q.29 The battle of Kamal (1739) was won by Persian King Nadir Shah by defeating the army of _____.

Ans
1. Ghulam Muhammad Ghouse Khan
2. Mughal Emperor, Muhammad Shah
3. Shuja-ud-Daulah, the Nawab of Awadh
4. Ghiyas-ud-din Balban

Question ID : **9895807427**
Chosen Option : **2**

Q.30 Titan the second largest moon in our solar system orbits around the planet _____.

Ans
1. Jupiter
2. Neptune
3. Saturn
4. Uranus

Question ID : **9895807424**
Chosen Option : **3**

Q.31 Fundamental duties in the Indian constitution are borrowed from the constitution of _____.

Ans
1. Britain
2. Canada
3. France
4. USSR

Question ID : **9895807414**
Chosen Option : **4**

Q.32 Name the unit in which the calorific value of fuel is expressed.

Ans
1. Kilojoule
2. Kilogram
3. Kelvin
4. Candela

Question ID : **9895807420**
Chosen Option : **1**

Q.33 Which island emerged in the Bay of Bengal in the aftermath of the Bhola cyclone in 1970?

Ans
1. Ghoramara Island
2. Jambudwip

Career Aglasem

✗ 3. Lohachara Island
✓ 4. New Moore Island

Question ID : **9895807423**
Chosen Option : **2**

Q.34 The fundamental rights of citizens are embodied in which part of the Indian Constitution?

Ans
✓ 1. Part III
✗ 2. Part IVA
✗ 3. Part I
✗ 4. Part VII

Question ID : **9895807415**
Chosen Option : **1**

Q.35 Centripetal force 'F' required for circular motion of an object of mass 'm' moving in a circle of radius 'r' at a tangential velocity 'v' is equal to _____.

Ans
✗ 1. mr^2/v
✗ 2. mv/r^2
✓ 3. mv^2/r
✗ 4. mr/v^2

Question ID : **9895807417**
Chosen Option : **3**

Q.36 The women's team from which country won the 2018 Carrom World Cup, held in South Korea?

Ans
✓ 1. India
✗ 2. South Korea
✗ 3. Japan
✗ 4. China

Question ID : **9895807406**
Chosen Option : **1**

Q.37 Which of the following dances is a dance form from Arunachal Pradesh?

Ans
✗ 1. Lezim
✗ 2. Chiraw
✗ 3. Macha
✓ 4. Popir

Question ID : **9895807405**
Chosen Option : **3**

Q.38 Minimum Support Price for 2018-19 for Jowar of the Hybrid variety is set at _____.

Ans
✗ 1. ₹5,150 per quintal
✗ 2. ₹1,750 per quintal
✓ 3. ₹2,430 per quintal

✗ 4. ₹1,950 per quintal

Question ID : **9895807413**
Chosen Option : **3**

Q.39 The Union Budget 2018 announced that Operation Green will be launched for agriculture with a corpus of _____.

Ans
✗ 1. ₹1,000 crore
✗ 2. ₹100 crore
✓ 3. ₹500 crore
✗ 4. ₹5,000 crore

Question ID : **9895807412**
Chosen Option : **4**

Q.40 The Economic Survey report 2017-18 stated that the Agriculture growth in FY18 was likely to be at _____.

Ans
✓ 1. 2.10%
✗ 2. 3.90%
✗ 3. 4.30%
✗ 4. 5.50%

Question ID : **9895807411**
Chosen Option : **4**

Q.41 Tesla is the unit of _____.

Ans
✗ 1. electric conductance
✓ 2. magnetic flux density
✗ 3. capacitance
✗ 4. magnetic flux

Question ID : **9895807418**
Chosen Option : **4**

Q.42 Name the Indian ruler of Harkanya dynasty who was the son of Ajatashatru and who laid the foundation of the city of Pataliputra.

Ans
✗ 1. Nandivardhana
✗ 2. Mahanandin
✗ 3. Pradyota
✓ 4. Udayin

Question ID : **9895807425**
Chosen Option : **4**

Q.43 Name the Bharat Ratna recipient who was a social reformer and educator. He played a vital role in the upliftment of women.

Ans
✗ 1. Govind Ballabh Pant
✗ 2. M Visvesvaraya
✓ 3. Dhondo Keshav Karve
✗ 4. Bidhan Chandra Roy

Question ID : **9895807408**
Chosen Option : **1**

Q.44 Which of the following is a book by Vikram Seth?

Ans
1. ✔ Riot At Misri Mandi
2. ✘ The Ocean of Churn
3. ✘ The Mistress of Spices
4. ✘ River of Smoke

Question ID : **9895807409**
Chosen Option : **1**

Q.45 The humerus is part of the _____.

Ans
1. ✘ leg
2. ✔ arm
3. ✘ shoulder girdle
4. ✘ spine

Question ID : **9895807421**
Chosen Option : **1**

Q.46 Which gland controls the functioning of other endocrine glands?

Ans
1. ✔ Pituitary gland
2. ✘ Pineal Gland
3. ✘ Thyroid Gland
4. ✘ Adrenal glands

Question ID : **9895807419**
Chosen Option : **1**

Q.47 The _____ was an Act of the Parliament of Great Britain intended to overhaul the management of the East India Company's rule in India.

Ans
1. ✘ Government of India Act of 1858
2. ✘ Indian Councils Act of 1861
3. ✘ Pitt's India Act
4. ✔ Regulating Act 1773

Question ID : **9895807416**
Chosen Option : **4**

Q.48 Who is the first Indian to win the Miss Earth pageant since its inception in 2001?

Ans
1. ✔ Nicole Faria
2. ✘ Reita Faria
3. ✘ Dia Mirza
4. ✘ Priyanka Chopra

Question ID : **9895807410**
Chosen Option : **3**

Q.49 Name the first Indian to qualify for the Indian Civil Service.

Ans
1. V. O. Chidambaram Pillai ✗
2. Satyendranath Tagore ✓
3. Dadabhai Naoroji ✗
4. Bankim Chandra Chatterjee ✗

Question ID : **9895807426**
Chosen Option : **2**

Q.50 Which city is NOT situated on the Banks of the Chambal River?

Ans
1. Dholpur ✗
2. Gwalior ✗
3. Kota ✗
4. Jabalpur ✓

Question ID : **9895807422**
Chosen Option : **3**

Q.51 Gold is 12 times as heavy as aluminum and copper is 5 times as heavy as aluminum. In what ratio gold and copper should be mixed to get an alloy 8 times of aluminum.

Ans
1. 1 : 2 ✗
2. 3 : 4 ✓
3. 2 : 1 ✗
4. 4 : 3 ✗

Question ID : **9895807739**
Chosen Option : **2**

Q.52

Production of Fertilizers by a Company

(in 1000 tonnes) Over the Years

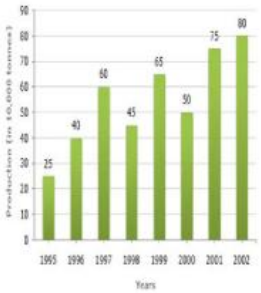

Study the bar chart and answer the question based on it.

The average production of 1999 and 2000 was less than the average production of which of the following pairs of years?

Ans
1. 2000 and 2001 ✓
2. 1995 and 2001 ✗
3. 1998 and 2000 ✗
4. 1996 and 1997 ✗

Question ID : **9895807752**
Chosen Option : **1**

Q.53

3 Vishal covers a distance of 20km in 30min. If he covers half of the distance in 18 min, what should be his speed to cover the remaining distance and completes the whole journey in 30min.

Ans
1. 55 km/hr
2. 65 km/hr
3. 60 km/hr
4. 50 km/hr

Question ID : **9895807746**
Chosen Option : **4**

Q.54 A cloth was 50cm broad and 8 cm long. When washed, it was found to have lost 25% of its length and 14% of its breath. Then the percentage decreased in area is _____.

Ans
1. 34.5%
2. 35.5%
3. 36%
4. 35%

Question ID : **9895807749**
Chosen Option : **2**

Q.55 Find the number of years in which an amount invested at 8% p.a. simple interest doubles itself.

Ans
1. 11 years
2. 12 years
3. 12 ½ years
4. 10 ½ years

Question ID : **9895807741**
Chosen Option : **3**

Q.56 Manjeet singh sold an article for ₹ 9000 gaining $\frac{1}{5}$ of its C.P. Find the gain % .

Ans
1. 22%
2. 10%
3. 25%
4. 20%

Question ID : **9895807736**
Chosen Option : **4**

Q.57 In an election contest between A and B, A wins by the margin of 480 votes. If A gets 70% of the total votes, then total votes are

Ans
1. 4800
2. 1200
3. 1400
4. 1600

Question ID : **9895807735**
Chosen Option : **2**

Q.58

Career Aglasem

Production of Fertilizers by a Company

(in 1000 tonnes) Over the Years

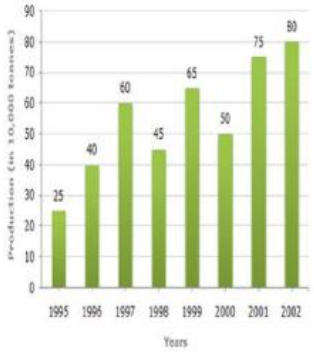

Study the bar chart and answer the question based on it.

What was the percentage increase in the production of fertilizers in 2001compared to that in 2000?

Ans
1. 30%
2. 25%
3. 50%
4. 40%

Question ID : **9895807750**
Chosen Option : **3**

Q.59 In a mixture of 60 liters, milk and water are in the ratio 2:1, find the quantity of water to be added to make the ratio 4:3

Ans
1. 20 liters
2. 10 liters
3. 15 liters
4. 12 liters

Question ID : **9895807738**
Chosen Option : **2**

Q.60 Simplify:

$$\frac{5.25 + \frac{3}{4} of\ 16 - 5}{\frac{1}{2} of\ (9.5 - 2.5) - (5 \times 0.35)}$$

Ans
1. 4
2. 7
3. 5
4. 6

Question ID : **9895807730**
Chosen Option : **2**

Q.61 If a shopkeeper gives 20% discount and then 15% discount on a book, which has the marked price of ₹850, how much would be the selling price of the book?

Ans
1. ₹578
2. ₹785
3. ₹758

✗ 4. ₹587

Question ID : **9895807733**
Chosen Option : **1**

Q.62 Simplify:

$7.8 - 0.4 \text{ of } (5.1 - 3.8) + 9.3 \times 1.5$

Ans
✗ 1. 23.12
✗ 2. 12.23
✓ 3. 21.23
✗ 4. 23.21

Question ID : **9895807729**
Chosen Option : **3**

Q.63 If 15 workers can earn ₹1,800 in 10 days. Find the earning (in ₹) of 5 workers in 8 days.

Ans
✓ 1. ₹480
✗ 2. ₹540
✗ 3. ₹360
✗ 4. ₹400

Question ID : **9895807743**
Chosen Option : **1**

Q.64 The price of a scooter which was bought for ₹84,000 depreciates at the rate of 10% p.a. Find its price after 2 years?

Ans
✓ 1. ₹68040
✗ 2. ₹46080
✗ 3. ₹64800
✗ 4. ₹86040

Question ID : **9895807742**
Chosen Option : **1**

Q.65 What is the least number which when increased by 8 is exactly divisible by 4, 5, 6 and 7?

Ans
✗ 1. 322
✓ 2. 412
✗ 3. 312
✗ 4. 422

Question ID : **9895807728**
Chosen Option : **2**

Q.66 A is twice as good as a workman as B. And together, they finish a piece of work in 20 days. In how many days, will A alone finish the work?

Ans
✗ 1. 26 days
✓ 2. 30 days
✗ 3. 28 days
✗ 4. 25 days

Question ID : **9895807744**
Chosen Option : **2**

Q.67

Production of Fertilizers by a Company

(in 1000 tonnes) Over the Years

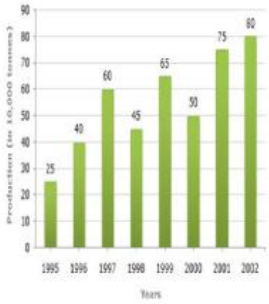

Study the bar chart and answer the question based on it.

In how many of the given years was the production of fertilizers less than the average production of the given years?

Ans
1. ✗ 2
2. ✗ 3
3. ✗ 1
4. ✓ 4

Question ID : **9895807751**
Chosen Option : **4**

Q.68 Out of 12 terms, the average of first 6 terms is 36 and that of last 6 terms is 42. If the average of first 11 terms is 38, find the 12th term.

Ans
1. ✗ 40
2. ✗ 42
3. ✗ 44
4. ✓ 50

Question ID : **9895807732**
Chosen Option : **4**

Q.69 The mean of a, b, c, d and e is 36. If the mean of b, d and e is 32, what is the mean of a and c?

Ans
1. ✗ 46
2. ✓ 42
3. ✗ 44
4. ✗ 24

Question ID : **9895807734**
Chosen Option : **2**

Q.70 Om Prakash travels Bombay to Pune at a speed of 80km/hr and returns back to Bombay by increasing his speed by 50%, then his average speed for the whole journey is _____.

Ans
1. ✗ 65 km/hr
2. ✗ 69 km/hr
3. ✓ 96 km/hr
4. ✗ 67 km/hr

Question ID : **9895807745**

Chosen Option : **3**

Q.71 Sum of five consecutive even numbers is 40 more than the average of the numbers. Find the middle number in the series.

Ans
✔ 1. 10
✘ 2. 40
✘ 3. 30
✘ 4. 20

Question ID : **9895807731**
Chosen Option : **1**

Q.72 A cuboidal tank has 48000 liters of water. Find the depth of water in the tank if length of the tank is 6m and breadth is 4m.

Ans
✘ 1. 6 m
✘ 2. 3 m
✘ 3. 4 m
✔ 4. 2 m

Question ID : **9895807747**
Chosen Option : **4**

Q.73 If all the sides of a square are increased by 20%, then the area is increased by _____.

Ans
✔ 1. 44%
✘ 2. 45%
✘ 3. 46%
✘ 4. 43%

Question ID : **9895807748**
Chosen Option : **1**

Q.74 A merchant claims that he sells his goods at CP. But uses a weight of 900g for the 1kg weight, find his gain %

Ans
✘ 1. 12%
✘ 2. $12\frac{1}{9}\%$
✔ 3. $11\frac{1}{9}\%$
✘ 4. 11%

Question ID : **9895807737**
Chosen Option : **3**

Q.75 If ₹3800 is distributed among A, B, C such that A : B = 1 : 2 and B : C = 3 : 5, the find the share of B.

Ans
✘ 1. ₹2000
✘ 2. ₹1400
✘ 3. ₹600
✔ 4. ₹1200

Question ID : **9895807740**
Chosen Option : **4**

Section : **English Language**

Comprehension:

In the following passage some words have been deleted. Fill in the blanks with the help of the alternatives given.

Students should develop a quality of (1) _____ to elders and respecting their views. Their experience and knowledge can play a major role in shaping a student's personality and career. Students should (2) _____ this much - needed knowledge and experience from parents and teachers. Being (3) _____ helps students to keep themselves morally high. One should not get carried away by success. Students should also learn to respect (4) _____ views and cope with diverse situations. These qualities will play a vital role in the (5) _____ of teamwork and leadership skills.

SubQuestion No : 1

Q.1 Select the most appropriate option that will fill in the blank number 1.

Ans
✔ 1. listen
✘ 2. listens
✘ 3. listening
✘ 4. listened

Question ID : **9895808070**
Chosen Option : --

Comprehension:

In the following passage some words have been deleted. Fill in the blanks with the help of the alternatives given.

Students should develop a quality of (1) _____ to elders and respecting their views. Their experience and knowledge can play a major role in shaping a student's personality and career. Students should (2) _____ this much - needed knowledge and experience from parents and teachers. Being (3) _____ helps students to keep themselves morally high. One should not get carried away by success. Students should also learn to respect (4) _____ views and cope with diverse situations. These qualities will play a vital role in the (5) _____ of teamwork and leadership skills.

SubQuestion No : 2

Q.2 Select the most appropriate option that will fill in the blank number 2.

Ans
✘ 1. access
✘ 2. measure
✔ 3. acquire
✘ 4. assess

Question ID : **9895808071**
Chosen Option : --

Comprehension:

In the following passage some words have been deleted. Fill in the blanks with the help of the alternatives given.

Students should develop a quality of (1) _____ to elders and respecting their views. Their experience and knowledge can play a major role in shaping a student's personality and career. Students should (2) _____ this much - needed knowledge and experience from parents and teachers. Being (3) _____ helps students to keep themselves morally high. One should not get carried away by success. Students should also learn to respect (4) _____ views and cope with diverse situations. These qualities will play a vital role in the (5) _____ of teamwork and leadership skills.

SubQuestion No : 3

Q.3 Select the most appropriate option that will fill in the blank number 3.

Ans
✗ 1. sharp
✗ 2. simple
✗ 3. intelligent
✓ 4. smart

Question ID : **9895808072**
Chosen Option : --

Comprehension:

In the following passage some words have been deleted. Fill in the blanks with the help of the alternatives given.

Students should develop a quality of (1) _____ to elders and respecting their views. Their experience and knowledge can play a major role in shaping a student's personality and career. Students should (2) _____ this much - needed knowledge and experience from parents and teachers. Being (3) _____ helps students to keep themselves morally high. One should not get carried away by success. Students should also learn to respect (4) _____ views and cope with diverse situations. These qualities will play a vital role in the (5) _____ of teamwork and leadership skills.

SubQuestion No : 4

Q.4 Select the most appropriate option that will fill in the blank number 4.

Ans
✓ 1. typical
✗ 2. different
✗ 3. general
✗ 4. expressive

Question ID : **9895808073**
Chosen Option : --

Comprehension:

In the following passage some words have been deleted. Fill in the blanks with the help of the alternatives given.

Students should develop a quality of (1) _____ to elders and respecting their views. Their experience and knowledge can play a major role in shaping a student's personality and career. Students should (2) _____ this much - needed knowledge and experience from parents and teachers. Being (3) _____ helps students to keep themselves morally high. One should not get carried away by success. Students should also learn to respect (4) _____ views and cope with diverse situations. These qualities will play a vital role in the (5) _____ of teamwork and leadership skills.

SubQuestion No : 5

Q.5 Select the most appropriate option that will fill in the blank number 5.

Ans
✗ 1. structure
✓ 2. development
✗ 3. manufacture
✗ 4. arrangement

Question ID : **9895808074**
Chosen Option : --

Q.6 From the given options, identify the segment in the sentence which contains the grammatical error.

A mere 43% of Indian woman own cellular phones, as opposed to almost 80% of men.

Ans
✓ 1. A mere 43% of Indian woman
✗ 2. as opposed to
✗ 3. almost 80% of men
✗ 4. own cellular phones

Question ID : **9895808063**
Chosen Option : --

Q.7 Select the most appropriate option to fill in the blank.

People high in humility avoid expecting _____ special treatment.

Ans
✓ 1. one
✗ 2. none
✗ 3. any
✗ 4. only

Question ID : **9895808067**
Chosen Option : --

Q.8 Select the option that means the same as the given idiom.

Bark up the wrong tree.

Ans
✓ 1. To send dogs to track someone
✗ 2. To make no mistakes about doing something

3. To make dogs bark at cats hiding in trees

4.

To be wrong about the reason for or way of doing something

Question ID : **9895808080**
Chosen Option : --

Q.9 Select the correctly spelt word.

Ans
1. Vegaitarian
2. Vegetarian
3. Vezetarian
4. Vegetaranian

Question ID : **9895808083**
Chosen Option : --

Q.10 Select the most appropriate option to substitute the underlined segment in the given sentence. If there is no need to substitute it, select No improvement.

The National Sample Survey Directorate is first set up under the Ministry of Finance in 1950.

Ans
1. Directorate had first set up
2. No improvement
3. Directorate was first set up
4. Directorate were first set up

Question ID : **9895808065**
Chosen Option : --

Q.11 Select the most appropriate word to fill in the blank.

The news of the general elections was covered by _____ media.

Ans
1. sole
2. single
3. multiple
4. singular

Question ID : **9895808085**
Chosen Option : --

Q.12 Select the correctly spelt word.

Ans
1. Audibal
2. Audeuble
3. Audible
4. Audiable

Question ID : **9895808084**
Chosen Option : --

Q.13

Career Aglasem

From the given options, identify the segment in the sentence which contains the grammatical error.

An excellent response for his readers refreshes the author and stirs his creative sense and functional skills.

Ans
✗ 1. his creative sense
✗ 2. functional skills
✓ 3. An excellent response
✗ 4. for his readers refreshes

Question ID : **9895808061**
Chosen Option : --

Q.14 Select the most appropriate option to substitute the underlined segment in the given sentence. If there is no need to substitute it, select No improvement.

Your promotion will be depend the quality of your work.

Ans
✓ 1. depends upon
✗ 2. depend on
✗ 3. will be dependent
✗ 4. No improvement

Question ID : **9895808066**
Chosen Option : --

Q.15 Select the antonym of the given word.

COMMENCE

Ans
✗ 1. Start
✗ 2. Clamp
✓ 3. Pause
✗ 4. Close

Question ID : **9895808077**
Chosen Option : --

Q.16 Select the most appropriate word to fill in the blank.

A software tool used to read electronic documents is known as _____.

Ans
✗ 1. internet
✗ 2. motherboard
✗ 3. broadband
✓ 4. browser

Question ID : **9895808086**
Chosen Option : --

Q.17 Select the option that means the same as the given idiom.

To bite off more than you can chew.

Ans
✗ 1. To take on a task too big for oneself
✗ 2. To finish a work in bits and pieces
✗ 3. To challenge someone to do difficult work

Career Aglasem

✔ 4. To eat very heavy and rich food

Question ID : **9895808079**
Chosen Option : --

Q.18 Select the word which means the same as the group of words given.

Concerning appreciation of art.

Ans
✘ 1. Particularistic
✔ 2. Idealistic
✘ 3. Poetic
✘ 4. Aesthetic

Question ID : **9895808081**
Chosen Option : --

Q.19 Select the word which means the same as the group of words given.

A story, poem or a picture that can be interpreted to reveal a hidden meaning.

Ans
✔ 1. Simile
✘ 2. Representation
✘ 3. Allegory
✘ 4. Resemblance

Question ID : **9895808082**
Chosen Option : --

Q.20 Select the synonym of the given word.

RIDDLE

Ans
✔ 1. Response
✘ 2. Game
✘ 3. Puzzle
✘ 4. Reaction

Question ID : **9895808075**
Chosen Option : --

Q.21 Select the antonym of the given word.

EXPAND

Ans
✘ 1. Contract
✔ 2. Express
✘ 3. Deposit
✘ 4. Collect

Question ID : **9895808078**
Chosen Option : --

Q.22

Career Aglasem

Select the most appropriate option to substitute the underlined segment in the given sentence. If there is no need to substitute it, select No improvement.

While participating in the marathon an eighteen year old girl was knocked for by a passing truck.

Ans
1. knocked up by ✗
2. No improvement ✗
3. knocked down by ✓
4. knocked in by ✗

Question ID : **9895808064**
Chosen Option : --

Q.23 Select the synonym of the given word.

IMPLICIT

Ans
1. Unheard ✗
2. Tacit ✓
3. Honest ✗
4. Unclear ✗

Question ID : **9895808076**
Chosen Option : --

Q.24 Select the most appropriate option to fill in the blank.

Online shopping platforms provide _____ information on books, groceries, medicines, etc.so that we can get the latest products.

Ans
1. old ✗
2. instant ✗
3. timeworn ✓
4. previous ✗

Question ID : **9895808068**
Chosen Option : --

Q.25 From the given options, identify the segment in the sentence which contains the grammatical error.

In India, child labour is a socio - economic issue that need urgent attention by everyone.

Ans
1. that need urgent attention ✗
2. socio - economic issue ✗
3. by everyone. ✗
4. child labour is a ✓

Question ID : **9895808062**
Chosen Option : --

Section : **Hindi Language**

Q.1 रिक्त स्थान को भरने के लिए उपयुक्त शब्द का चयन करें।

भगवान सबका _____ करे।

Ans
1. भली ✗
2. भला ✓

✗ 3. कृपा

✗ 4. दया

Question ID : **9895806847**
Chosen Option : **2**

Q.2 निम्नलिखित में से उस विकल्प का चयन करें जो 'एक ही राग अलापना' मुहावरे का अर्थ व्यक्त करता है।

Ans ✗ 1. कोई बात एक ही बार कहना

✗ 2. कई बात एक साथ कहना

✗ 3. सुर में सुर मिलाना

✓ 4. एक ही बात बार-बार कहना

Question ID : **9895806859**
Chosen Option : **4**

Q.3 दिए गए शब्द का विलोम चुनें।

ऐश्वर्य

Ans ✗ 1. शान

✓ 2. दरिद्रता

✗ 3. शक्ति

✗ 4. भक्ति

Question ID : **9895806855**
Chosen Option : **2**

Comprehension:

निम्नलिखित गद्यांश के रिक्त स्थानों की पूर्ति गद्यांश के नीचे दिए गए प्रश्नों के अनुसार कीजिए-

होली के पर्व के पीछे एक लोकप्रिय पौराणिक _____ (1) है। हिरण्यकश्यप एक राक्षस राजा था। उसका एक बेटा था जिसका नाम प्रह्लाद था। _____ (2) भगवन विष्णु का भक्त था। ये बात उसके पिता को पसंद नहीं थी। पिता के कई बार _____ (3) के बाद भी प्रह्लाद ने अपनी विष्णु भक्ति नहीं छोड़ी। हिरण्यकश्यप ने अपने ही बेटे को कई तरह की सजायें दी _____ (4) ईश्वर की कृपा से वह हर बार बच जाता था। एक दिन क्रोधित _____ (5) हिरण्यकश्यप ने अपनी बहन होलिका को अपने बेटे का वध करने के लिए बुलाया।

SubQuestion No : 4

Q.4 गद्यांश में संकेतित रिक्त स्थान (1) के लिए उपयुक्त शब्द होगा।

Ans ✓ 1. कथा

✗ 2. दर्शन

✗ 3. निबंध

Career Aglasem

✗ 4. कविता

Question ID : **9895806850**
Chosen Option : **1**

Comprehension:

निम्नलिखित गद्यांश के रिक्त स्थानों की पूर्ति गद्यांश के नीचे दिए गए प्रश्नों के अनुसार कीजिए-

होली के पर्व के पीछे एक लोकप्रिय पौराणिक _____ (1) है। हिरण्यकश्यप एक राक्षस राजा था। उसका एक बेटा था जिसका नाम प्रहलाद था। _____ (2) भगवन विष्णु का भक्त था। ये बात उसके पिता को पसंद नहीं थी। पिता के कई बार _____ (3) के बाद भी प्रहलाद ने अपनी विष्णु भक्ति नहीं छोड़ी। हिरण्यकश्यप ने अपने ही बेटे को कई तरह की सजायें दी _____ (4) ईश्वर की कृपा से वह हर बार बच जाता था। एक दिन क्रोधित _____ (5) हिरण्यकश्यप ने अपनी बहन होलिका को अपने बेटे का वध करने के लिए बुलाया।

SubQuestion No : 5

Q.5 गद्यांश में संकेतित रिक्त स्थान (2) के लिए उपयुक्त शब्द होगा।

Ans ✓ 1. वह

✗ 2. उसने

✗ 3. वे

✗ 4. उन्होंने

Question ID : **9895806851**
Chosen Option : **1**

Comprehension:

निम्नलिखित गद्यांश के रिक्त स्थानों की पूर्ति गद्यांश के नीचे दिए गए प्रश्नों के अनुसार कीजिए-

होली के पर्व के पीछे एक लोकप्रिय पौराणिक _____ (1) है। हिरण्यकश्यप एक राक्षस राजा था। उसका एक बेटा था जिसका नाम प्रहलाद था। _____ (2) भगवन विष्णु का भक्त था। ये बात उसके पिता को पसंद नहीं थी। पिता के कई बार _____ (3) के बाद भी प्रहलाद ने अपनी विष्णु भक्ति नहीं छोड़ी। हिरण्यकश्यप ने अपने ही बेटे को कई तरह की सजायें दी _____ (4) ईश्वर की कृपा से वह हर बार बच जाता था। एक दिन क्रोधित _____ (5) हिरण्यकश्यप ने अपनी बहन होलिका को अपने बेटे का वध करने के लिए बुलाया।

SubQuestion No : 6

Q.6 गद्यांश में संकेतित रिक्त स्थान (3) के लिए उपयुक्त शब्द होगा।

Ans ✗ 1. दुलार करने

Career Aglasem

✔ 2. समझाने

✘ 3. निवेदन करने

✘ 4. प्यार करने

Question ID : **9895806852**
Chosen Option : **2**

Comprehension:

निम्नलिखित गद्यांश के रिक्त स्थानों की पूर्ति गद्यांश के नीचे दिए गए प्रश्नों के अनुसार कीजिए-

होली के पर्व के पीछे एक लोकप्रिय पौराणिक _____ (1) है। हिरण्यकश्यप एक राक्षस राजा था। उसका एक बेटा था जिसका नाम प्रहलाद था। _____ (2) भगवन विष्णु का भक्त था। ये बात उसके पिता को पसंद नहीं थी। पिता के कई बार _____ (3) के बाद भी प्रहलाद ने अपनी विष्णु भक्ति नहीं छोड़ी। हिरण्यकश्यप ने अपने ही बेटे को कई तरह की सजायें दी _____ (4) ईश्वर की कृपा से वह हर बार बच जाता था। एक दिन क्रोधित _____ (5) हिरण्यकश्यप ने अपनी बहन होलिका को अपने बेटे का वध करने के लिए बुलाया।

SubQuestion No : 7

Q.7 गद्यांश में संकेतित रिक्त स्थान (4) के लिए उपयुक्त शब्द होगा।

Ans ✘ 1. इसलिए

✔ 2. परन्तु

✘ 3. क्योंकि

✘ 4. अतः

Question ID : **9895806853**
Chosen Option : **2**

Comprehension:

निम्नलिखित गद्यांश के रिक्त स्थानों की पूर्ति गद्यांश के नीचे दिए गए प्रश्नों के अनुसार कीजिए-

होली के पर्व के पीछे एक लोकप्रिय पौराणिक _____ (1) है। हिरण्यकश्यप एक राक्षस राजा था। उसका एक बेटा था जिसका नाम प्रहलाद था। _____ (2) भगवन विष्णु का भक्त था। ये बात उसके पिता को पसंद नहीं थी। पिता के कई बार _____ (3) के बाद भी प्रहलाद ने अपनी विष्णु भक्ति नहीं छोड़ी। हिरण्यकश्यप ने अपने ही बेटे को कई तरह की सजायें दी _____ (4) ईश्वर की कृपा से वह हर बार बच जाता था। एक दिन क्रोधित _____ (5) हिरण्यकश्यप ने अपनी बहन होलिका को अपने बेटे का वध करने के लिए बुलाया।

SubQuestion No : 8

Q.8

Career Aglasem

गद्यांश में संकेतित रिक्त स्थान (5) के लिए उपयुक्त शब्द होगा।

Ans
1. बनकर ✗
2. होकर ✓
3. लगकर ✗
4. चलकर ✗

Question ID : **9895806854**
Chosen Option : **2**

Q.9 दिए गए शब्द के पर्यायवाची शब्द का चयन करें।

विपदा

Ans
1. आपदा ✓
2. निरपराध ✗
3. सुख ✗
4. मनीषी ✗

Question ID : **9895806858**
Chosen Option : **1**

Q.10 दिए गए वाक्य का वह भाग ज्ञात करें जिसमें कोई त्रुटि है।

विद्यालय में पढ़ाई करने के लिए अनेकों छात्र आए हुए थे।

Ans
1. पढ़ाई करने के लिए ✗
2. आए हुए थे। ✗
3. विद्यालय में ✗
4. अनेकों छात्र ✓

Question ID : **9895806841**
Chosen Option : **4**

Q.11 रिक्त स्थान को भरने के लिए उपयुक्त शब्द का चयन करें।

राजा हर्षवर्धन _____ करके लौटे।

Ans
1. नृत्य ✗
2. दिग्विजय ✓
3. नाटक ✗
4. चोरी ✗

Question ID : **9895806846**
Chosen Option : **2**

Q.12

Career Aglasem

दिए गए शब्द के पर्यायवाची शब्द का चयन करें।

तालाब

Ans
1. अरि
2. बाग
3. समुद्र
4. पोखर

Question ID : **9895806857**
Chosen Option : **4**

Q.13 रिक्त स्थान को भरने के लिए उपयुक्त शब्द का चयन करें।

मैं कलम से चिट्ठी _____ रहा हूँ।

Ans
1. सोच
2. भेज
3. पढ़
4. लिख

Question ID : **9895806848**
Chosen Option : **4**

Q.14 दिए गए वाक्य का वह भाग ज्ञात करें जिसमें कोई त्रुटि है।

मुख्य अतिथि का एक फूल की माला पहना कर स्वागत किया गया।

Ans
1. एक फूल की माला
2. मुख्य अतिथि का
3. पहना कर
4. स्वागत किया गया

Question ID : **9895806839**
Chosen Option : **2**

Q.15 सही वर्तनी वाले शब्द का चयन करें।

Ans
1. विस्तार
2. वीसतार
3. वीस्तार
4. विसतार

Question ID : **9895806864**
Chosen Option : **1**

Q.16 दिए गए वाक्य में रेखांकित खंड को प्रतिस्थापित करने के लिए उपयुक्त विकल्प का चयन करें।

धरणी पर बहुत सारी प्राकृतिक घटनाएं होती रहती हैं।

Ans

✔ 1. पृथ्वी

✘ 2. वृक्ष

✘ 3. समूह

✘ 4. भुजंग

Question ID : **9895806842**
Chosen Option : **1**

Q.17 रिक्त स्थान को भरने के लिए उपयुक्त शब्द का चयन करें।

मनुष्य को अपनी _____ नहीं छोड़नी चाहिए।

Ans ✘ 1. बचपन

✔ 2. मनुष्यता

✘ 3. अभिमान

✘ 4. क्रोध

Question ID : **9895806845**
Chosen Option : **2**

Q.18 दिए गए शब्द का विलोम चुनें।

खरा

Ans ✘ 1. सरल

✘ 2. सोना

✘ 3. साफ

✔ 4. खोटा

Question ID : **9895806856**
Chosen Option : **3**

Q.19 दिए गए वाक्य का वह भाग ज्ञात करें जिसमें कोई त्रुटि है।

अच्छे आभूषणों के द्वारा शरीर की शोभा बढ़ जाता है ।

Ans ✘ 1. के द्वारा

✔ 2. बढ़ जाता है।

✘ 3. अच्छे आभूषणों

✘ 4. शरीर की शोभा

Question ID : **9895806840**
Chosen Option : **1**

Q.20 दिये गये वाक्यांश के लिए एक शब्द दीजिये।

अच्छे चरित्र वाला

Ans ✔ 1. चरित्रवान

Career Aglasem

✗ 2. व्यभिचारी

✗ 3. दुष्चरित्र

✗ 4. चरित्रहीन

Question ID : **9895806861**
Chosen Option : **1**

Q.21 दिए गए वाक्य में रेखांकित खंड को प्रतिस्थापित करने के लिए उपयुक्त विकल्प का चयन करें।

पुराने समय में कपोत एक बहुत ही अच्छा संदेशक माना जाता था।

Ans
✗ 1. कोयल

✓ 2. कबूतर

✗ 3. डाकिया

✗ 4. अश्व

Question ID : **9895806843**
Chosen Option : **2**

Q.22 निम्नलिखित में से उस विकल्प का चयन करें जो 'रंगा सियार' मुहावरे का अर्थ व्यक्त करता है।

Ans
✗ 1. एक समान

✓ 2. धोखे बाज

✗ 3. सुंदर सियार

✗ 4. रँगा हुआ सियार

Question ID : **9895806860**
Chosen Option : **2**

Q.23 दिये गये वाक्यांश के लिए एक शब्द दीजिये।

लेख की नकल

Ans
✗ 1. नकलची

✗ 2. लिपि

✓ 3. प्रतिलिपि

✗ 4. हस्तलिपि

Question ID : **9895806862**
Chosen Option : **1**

Q.24 दिए गए वाक्य में रेखांकित खंड को प्रतिस्थापित करने के लिए उपयुक्त विकल्प का चयन करें।

कबीर बहुत सी भाषाएँ जानता है।

Ans
✓ 1. बहुभाषाविद्

✗ 2. भाषावैज्ञानिक

✗ 3. बहुज्ञ

✗ 4. तत्व चिन्तक

Career Aglasem

Question ID : **9895806844**
Chosen Option : **1**

Q.25 सही वर्तनी वाले शब्द का चयन करें।

Ans
1. अभीषेक
2. अभिषेक
3. अभिशेक
4. अभीशेक

Question ID : **9895806863**
Chosen Option : **2**

aglasem.com